Re-escribiendo problemas de multiplicación (Visual) Nombre:

Escribir cada matriz como un problema de multiplicación y resolver.

Ej)



1)

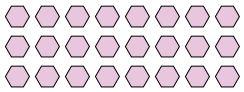

2)



3)



4)

5)



6)



7)

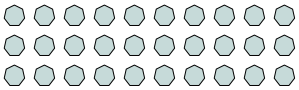

8)

9)

10)



11)



Respuestas

Ej. 8 × 7 = 56

1. _____
2. _____
3. _____
4. _____
5. _____
6. _____
7. _____
8. _____
9. _____
10. _____
11. _____

Re-escribiendo problemas de multiplicación (Visual) Nombre: **Clave De Respuestas**

Escribir cada matriz como un problema de multiplicación y resolver.

Ej)



1)

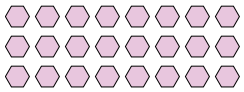

2)



3)



4)

5)



6)



7)

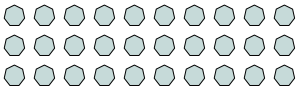

8)

9)

10)



11)



Respuestas

Ej. 8 × 7 = 56

1. 3 × 8 = 24
2. 4 × 3 = 12
3. 7 × 9 = 63
4. 2 × 10 = 20
5. 7 × 10 = 70
6. 6 × 4 = 24
7. 3 × 10 = 30
8. 2 × 3 = 6
9. 9 × 2 = 18
10. 6 × 5 = 30
11. 9 × 8 = 72

1-10	91	82	73	64	55	45	36	27	18	9
11	0									